2年数学 5 三角形と四角形	（１２） 特別な平行四辺形１	学習日　　月　　日（　　）

四角形 → 正方形 (辺や角の条件)

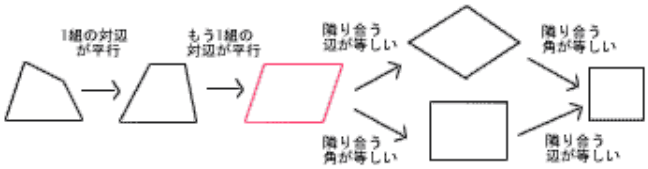

四角形 → 正方形 (対角線の条件)

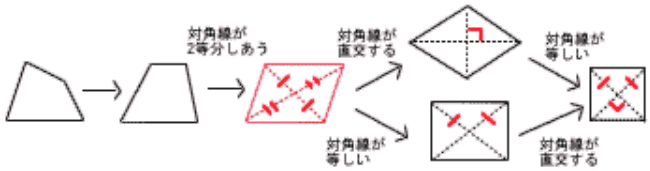

印刷して、紙の上でやってネ！

1　次のような▱ABCDはどんな四角形か,名前を答えなさい。

(1) AB＝BC

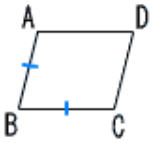

(2) ∠A＝∠B

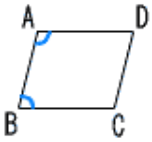

(3) ∠A＝90°

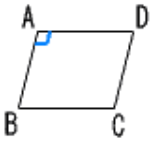

(4) AB＝BC
∠A＝90°

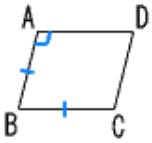

(5) AC⊥BD

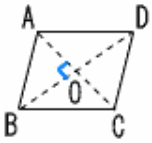

(6) ∠BAC＝∠DAC

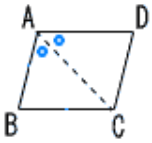

2　次のような四角形ABCDはどんな四角形か,名前を答えなさい。

(1) ∠A＝∠B＝∠C＝90°

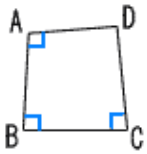

(2) OA＝OB＝OC＝OD

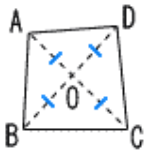

(3) ∠A＋∠B＝180°

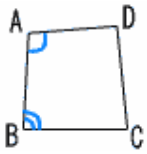

(4) ∠BAC＝∠CDA
∠B＝∠D＝90°

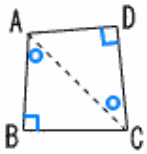

(5) ∠A＝∠B＝90°

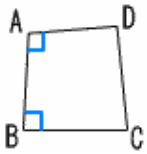
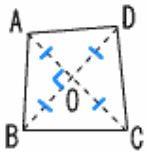
(6) ∠O＝90°
OA＝OB＝OC＝OD