1年数学 6 空間図形	（1） いろいろな立体	学習日　　月　　日（　　）

柱体
柱のような立体

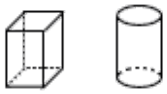

錐体
先のとがった立体

印刷して、紙の上でやってネ！

1

次の立体の名前を,語群から選びなさい。
［語群］ 三角柱,四角柱,六角柱,円柱,三角錐,四角錐,五角錐,円錐,球

(1) (　　)

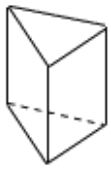

(2) (　　)

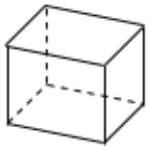

(3) (　　)

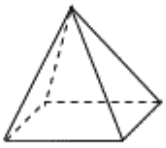

(4) (　　)

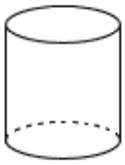

(5) (　　)

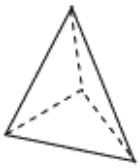

(6) (　　)

(7) (　　)

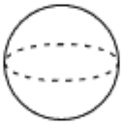

2

次の形の名前を答えなさい。

(1) 正四角柱の底面
(　　)

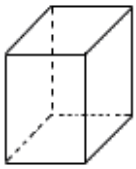

(2) 正四角柱の側面
(　　)

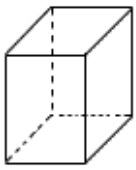

(3) 水平に切るとき,切り口の形
(　　)

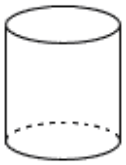

(4) 垂直に切るとき,切り口の形
(　　)

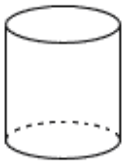

(5) 側面の形
(　　)

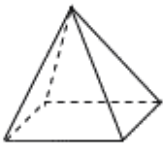

(6) 頂点から垂直に切るとき,切り口の形
(　　)

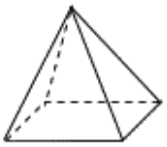
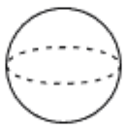
(7) 水平に切るとき,切り口の形
(　　)